# Real Life Graphs *ramp up*

**a** Convert 10 miles to km

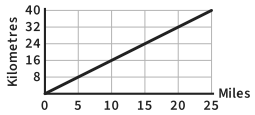


**b** Convert 24 km to miles

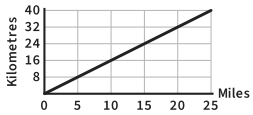


**c** Convert 50 miles to km

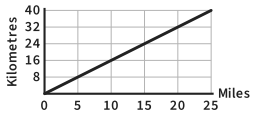


**d** Find the cost for 0 hours

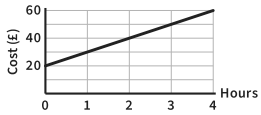


**e** How long is the stop?

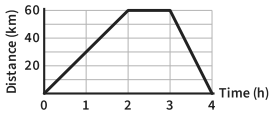


**f** Find the speed on the way out

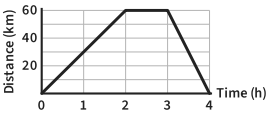


**g** Find the speed on the way back

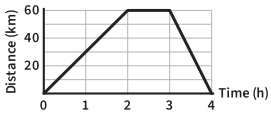


**h** Find the total distance travelled

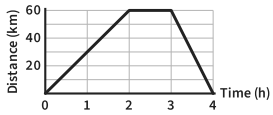


**i** Which part is the fastest?

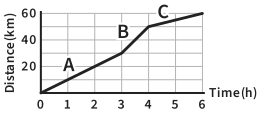


**j** Find the speed in km/h

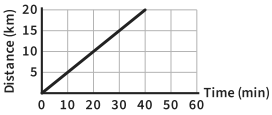


**k** When do P and Q meet?

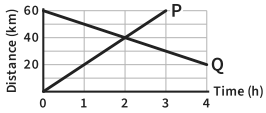


**l** Is it getting faster or slower?

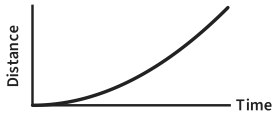


*The Maths Habit*


# Real Life Graphs *ramp up*

**a** Convert 10 miles to km

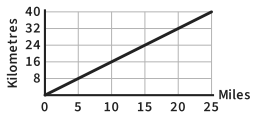


**b** Convert 24 km to miles

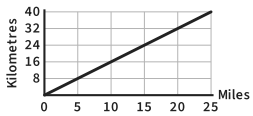


**c** Convert 50 miles to km

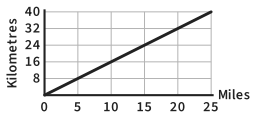


**d** Find the cost for 0 hours

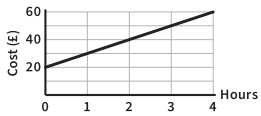


**e** How long is the stop?

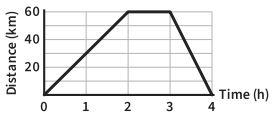


**f** Find the speed on the way out

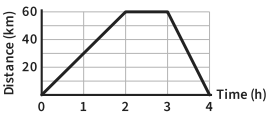


**g** Find the speed on the way back

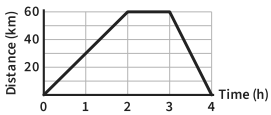


**h** Find the total distance travelled

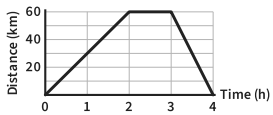


**i** Which part is the fastest?

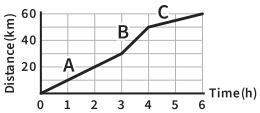


**j** Find the speed in km/h

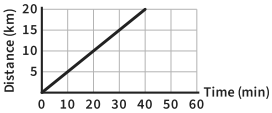


**k** When do P and Q meet?

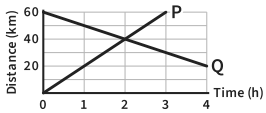


**l** Is it getting faster or slower?

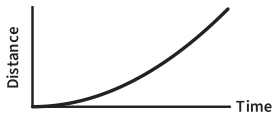


*The Maths Habit*