Congruent Triangles *ramp up*

a Are they congruent? Why?

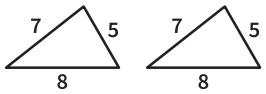

b Are they congruent? Why?

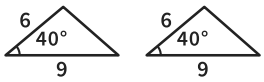

c Are they congruent? Why?

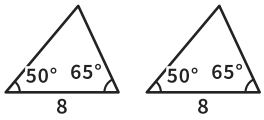

d Are they congruent? Why?

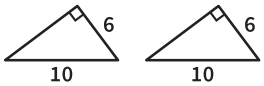

e Are they congruent? Why?

f Are they congruent? Why?

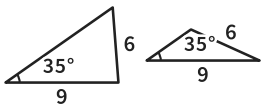

g Are they congruent? Why?

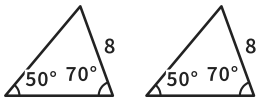

h Are they congruent? Why?

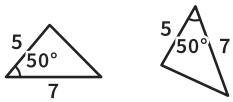

i The triangles are congruent. Find x

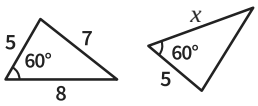

j The triangles are congruent. Find x

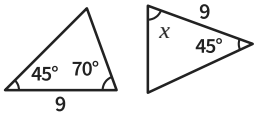

k Are they congruent? Why?

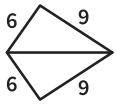

l Are they congruent? Why?

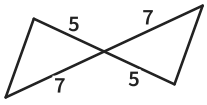

The Maths Habit

Congruent Triangles *ramp up*

a Are they congruent? Why?

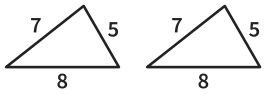

b Are they congruent? Why?

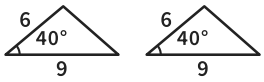

c Are they congruent? Why?

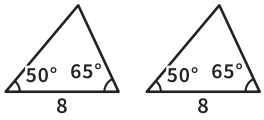

d Are they congruent? Why?

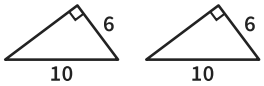

e Are they congruent? Why?

f Are they congruent? Why?

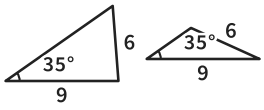

g Are they congruent? Why?

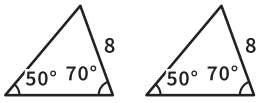

h Are they congruent? Why?

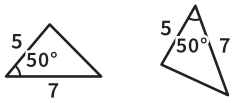

i The triangles are congruent. Find x

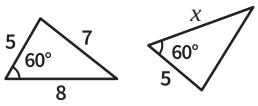

j The triangles are congruent. Find x

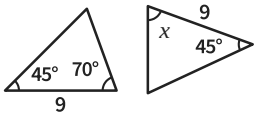

k Are they congruent? Why?

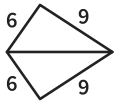

l Are they congruent? Why?

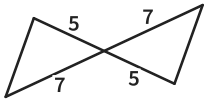

The Maths Habit