Circle Theorems *ramp up*

a Find angle x

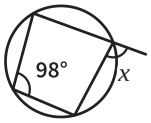

Not drawn accurately

b Find angle x

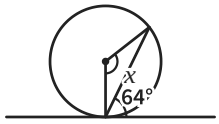

Not drawn accurately

c Find angle x

Not drawn accurately

d Find angle x

Not drawn accurately

e Find angle x

Not drawn accurately

f Find angle x

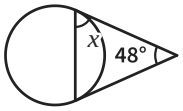

Not drawn accurately

g Find angle x

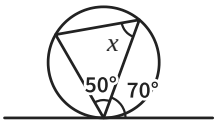

Not drawn accurately

h Find x

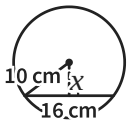

Not drawn accurately

i Find x

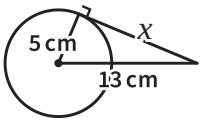

Not drawn accurately

j $a = 2x + 10$ and $b = 3x - 5$. Find x

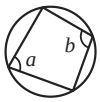

Not drawn accurately

k Find x

Not drawn accurately

l Find angle x

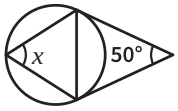

Not drawn accurately

The Maths Habit

Circle Theorems *ramp up*

a Find angle x

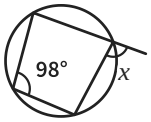

Not drawn accurately

b Find angle x

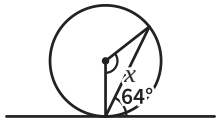

Not drawn accurately

c Find angle x

Not drawn accurately

d Find angle x

Not drawn accurately

e Find angle x

Not drawn accurately

f Find angle x

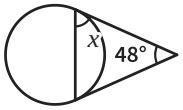

Not drawn accurately

g Find angle x

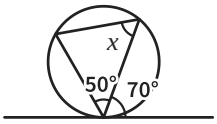

Not drawn accurately

h Find x

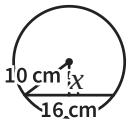

Not drawn accurately

i Find x

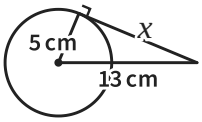

Not drawn accurately

j $a = 2x + 10$ and $b = 3x - 5$. Find x

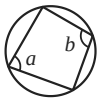

Not drawn accurately

k Find x

Not drawn accurately

l Find angle x

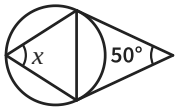

Not drawn accurately

The Maths Habit