Sum of interior angles

Exit ticket Name _____

1. Work out the sum of the interior angles of a polygon with 14 sides.

_____

2. A hexagon is not regular. Find angle x.

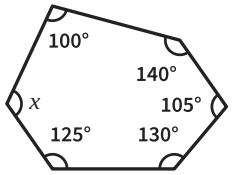

x = _____

3. A regular polygon has 18 sides. Work out the size of each interior angle.

_____

Sum of interior angles

Exit ticket Name _____

1. Work out the sum of the interior angles of a polygon with 14 sides.

_____

2. A hexagon is not regular. Find angle x.

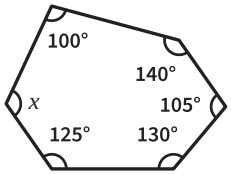

x = _____

3. A regular polygon has 18 sides. Work out the size of each interior angle.

_____

The Maths Habit

Sum of interior angles

Exit ticket Name _____

1. Work out the sum of the interior angles of a polygon with 14 sides.

_____

2. A hexagon is not regular. Find angle x.

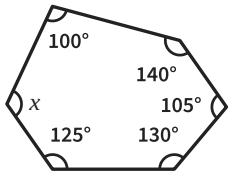

x = _____

3. A regular polygon has 18 sides. Work out the size of each interior angle.

_____

The Maths Habit

Sum of interior angles

Exit ticket Name _____

1. Work out the sum of the interior angles of a polygon with 14 sides.

_____

2. A hexagon is not regular. Find angle x.

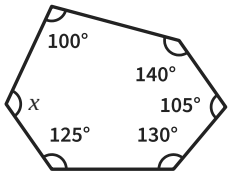

x = _____

3. A regular polygon has 18 sides. Work out the size of each interior angle.

_____

The Maths Habit

Sum of interior angles

Exit ticket Name _____

1. Work out the sum of the interior angles of a polygon with 14 sides.

_____

2. A hexagon is not regular. Find angle x.

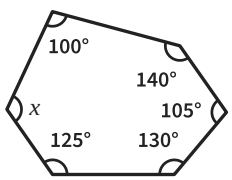

x = _____

3. A regular polygon has 18 sides. Work out the size of each interior angle.

_____

The Maths Habit

Sum of interior angles

Exit ticket Name _____

1. Work out the sum of the interior angles of a polygon with 14 sides.

_____

2. A hexagon is not regular. Find angle x.

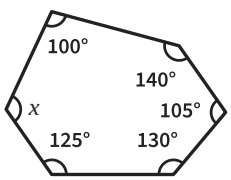

x = _____

3. A regular polygon has 18 sides. Work out the size of each interior angle.

_____

The Maths Habit