Sine rule: finding an angle

Exit ticket Name _____

1 $\sin x = 0.45$. Find x. Give your answer to 1 decimal place.

$x =$ _____

2 Find angle x. Give your answer to 1 decimal place.

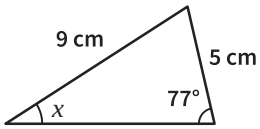

$x =$ _____

3 A side of 7 cm is opposite angle x. A side of 10 cm is opposite an angle of 58°. Find x to 1 decimal place.

$x =$ _____

The Maths Habit

Sine rule: finding an angle

Exit ticket Name _____

1 $\sin x = 0.45$. Find x. Give your answer to 1 decimal place.

$x =$ _____

2 Find angle x. Give your answer to 1 decimal place.

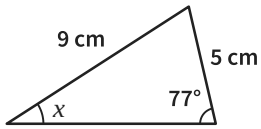

$x =$ _____

3 A side of 7 cm is opposite angle x. A side of 10 cm is opposite an angle of 58°. Find x to 1 decimal place.

$x =$ _____

The Maths Habit

Sine rule: finding an angle

Exit ticket Name _____

1 $\sin x = 0.45$. Find x. Give your answer to 1 decimal place.

$x =$ _____

2 Find angle x. Give your answer to 1 decimal place.

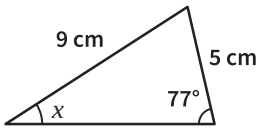

$x =$ _____

3 A side of 7 cm is opposite angle x. A side of 10 cm is opposite an angle of 58°. Find x to 1 decimal place.

$x =$ _____

The Maths Habit

Sine rule: finding an angle

Exit ticket Name _____

1 $\sin x = 0.45$. Find x. Give your answer to 1 decimal place.

$x =$ _____

2 Find angle x. Give your answer to 1 decimal place.

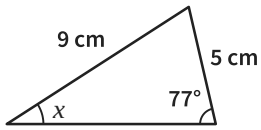

$x =$ _____

3 A side of 7 cm is opposite angle x. A side of 10 cm is opposite an angle of 58°. Find x to 1 decimal place.

$x =$ _____

The Maths Habit

Sine rule: finding an angle

Exit ticket Name _____

1 $\sin x = 0.45$. Find x. Give your answer to 1 decimal place.

$x =$ _____

2 Find angle x. Give your answer to 1 decimal place.

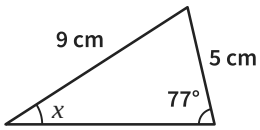

$x =$ _____

3 A side of 7 cm is opposite angle x. A side of 10 cm is opposite an angle of 58°. Find x to 1 decimal place.

$x =$ _____

The Maths Habit

Sine rule: finding an angle

Exit ticket Name _____

1 $\sin x = 0.45$. Find x. Give your answer to 1 decimal place.

$x =$ _____

2 Find angle x. Give your answer to 1 decimal place.

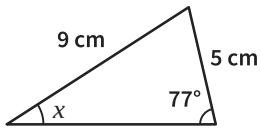

$x =$ _____

3 A side of 7 cm is opposite angle x. A side of 10 cm is opposite an angle of 58°. Find x to 1 decimal place.

$x =$ _____

The Maths Habit