Sine rule: finding a side

Exit ticket Name _____

1 Write the sine rule for this triangle with the numbers in.

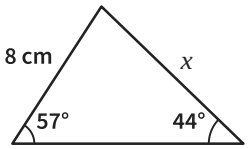

_____

2 Find x. Give your answer to 1 decimal place.

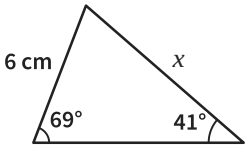

$x =$ _____

3 Find x. Give your answer to 1 decimal place.

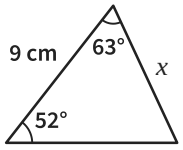

$x =$ _____

The Maths Habit

Sine rule: finding a side

Exit ticket Name _____

1 Write the sine rule for this triangle with the numbers in.

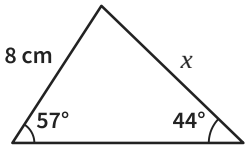

_____

2 Find x. Give your answer to 1 decimal place.

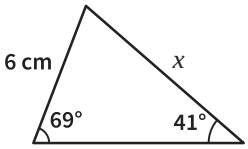

$x =$ _____

3 Find x. Give your answer to 1 decimal place.

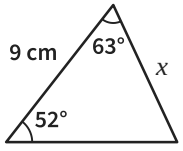

$x =$ _____

The Maths Habit

Sine rule: finding a side

Exit ticket Name _____

1 Write the sine rule for this triangle with the numbers in.

_____

2 Find x. Give your answer to 1 decimal place.

$x =$ _____

3 Find x. Give your answer to 1 decimal place.

$x =$ _____

The Maths Habit

Sine rule: finding a side

Exit ticket Name _____

1 Write the sine rule for this triangle with the numbers in.

_____

2 Find x. Give your answer to 1 decimal place.

$x =$ _____

3 Find x. Give your answer to 1 decimal place.

$x =$ _____

The Maths Habit

Sine rule: finding a side

Exit ticket Name _____

1 Write the sine rule for this triangle with the numbers in.

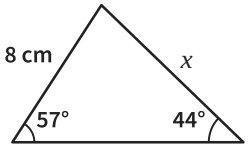

_____

2 Find x. Give your answer to 1 decimal place.

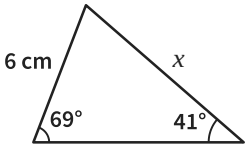

$x =$ _____

3 Find x. Give your answer to 1 decimal place.

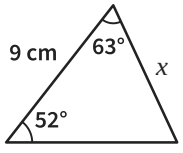

$x =$ _____

The Maths Habit

Sine rule: finding a side

Exit ticket Name _____

1 Write the sine rule for this triangle with the numbers in.

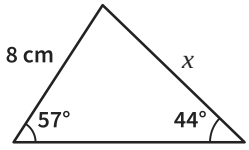

_____

2 Find x. Give your answer to 1 decimal place.

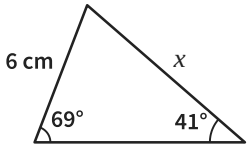

$x =$ _____

3 Find x. Give your answer to 1 decimal place.

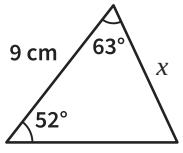

$x =$ _____

The Maths Habit