Pythagoras in 3D

Exit ticket Name _____

1 Find the length of the diagonal of the base of the cuboid.

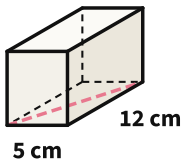

_____

2 The diagonal of the base of a cuboid is 20 cm. The height of the cuboid is 21 cm. Find the length of the diagonal of the cuboid.

_____

3 Find the length of the diagonal of the cuboid.

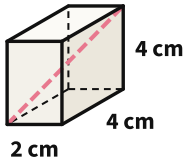

_____

The Maths Habit

Pythagoras in 3D

Exit ticket Name _____

1 Find the length of the diagonal of the base of the cuboid.

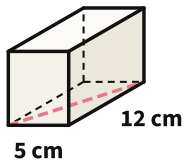

_____

2 The diagonal of the base of a cuboid is 20 cm. The height of the cuboid is 21 cm. Find the length of the diagonal of the cuboid.

_____

3 Find the length of the diagonal of the cuboid.

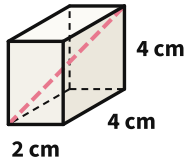

_____

The Maths Habit

Pythagoras in 3D

Exit ticket Name _____

1 Find the length of the diagonal of the base of the cuboid.

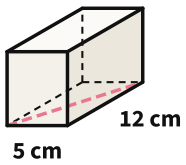

_____

2 The diagonal of the base of a cuboid is 20 cm. The height of the cuboid is 21 cm. Find the length of the diagonal of the cuboid.

_____

3 Find the length of the diagonal of the cuboid.

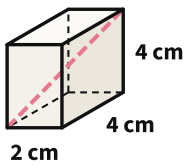

_____

The Maths Habit

Pythagoras in 3D

Exit ticket Name _____

1 Find the length of the diagonal of the base of the cuboid.

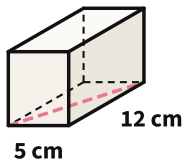

_____

2 The diagonal of the base of a cuboid is 20 cm. The height of the cuboid is 21 cm. Find the length of the diagonal of the cuboid.

_____

3 Find the length of the diagonal of the cuboid.

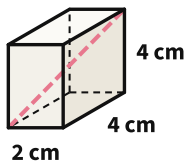

_____

The Maths Habit

Pythagoras in 3D

Exit ticket Name _____

1 Find the length of the diagonal of the base of the cuboid.

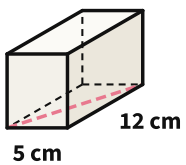

_____

2 The diagonal of the base of a cuboid is 20 cm. The height of the cuboid is 21 cm. Find the length of the diagonal of the cuboid.

_____

3 Find the length of the diagonal of the cuboid.

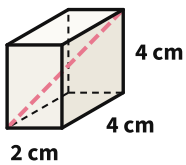

_____

The Maths Habit

Pythagoras in 3D

Exit ticket Name _____

1 Find the length of the diagonal of the base of the cuboid.

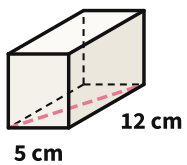

_____

2 The diagonal of the base of a cuboid is 20 cm. The height of the cuboid is 21 cm. Find the length of the diagonal of the cuboid.

_____

3 Find the length of the diagonal of the cuboid.

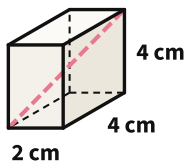

_____

The Maths Habit