Perimeter of compound shapes

Exit ticket Name _____

1 Work out the perimeter.

1 Missing ↔ 10 − 6 = ☐
↕ 6 − 3 = ☐

2 Add ☐ + ☐ + ☐ + ☐ + ☐ + ☐

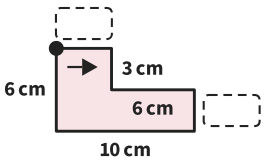

Perimeter = _____

2 Work out the perimeter.

1 Missing ↔ ☐ − ☐ = ☐
↕ ☐ − ☐ = ☐

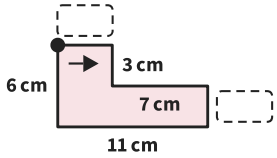

Perimeter = _____

3 Work out the perimeter.

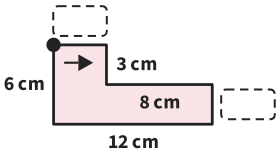

Perimeter = _____

The Maths Habit

Perimeter of compound shapes

Exit ticket Name _____

1 Work out the perimeter.

1 Missing ↔ 10 − 6 = ☐
↕ 6 − 3 = ☐

2 Add ☐ + ☐ + ☐ + ☐ + ☐ + ☐

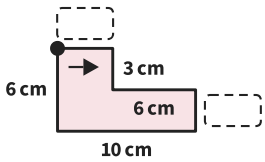

Perimeter = _____

2 Work out the perimeter.

1 Missing ↔ ☐ − ☐ = ☐
↕ ☐ − ☐ = ☐

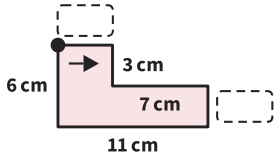

Perimeter = _____

3 Work out the perimeter.

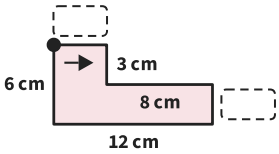

Perimeter = _____

The Maths Habit

Perimeter of compound shapes

Exit ticket Name _____

1 Work out the perimeter.

1 Missing ↔ 10 − 6 = ☐
↕ 6 − 3 = ☐

2 Add ☐ + ☐ + ☐ + ☐ + ☐ + ☐

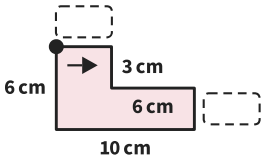

Perimeter = _____

2 Work out the perimeter.

1 Missing ↔ ☐ − ☐ = ☐
↕ ☐ − ☐ = ☐

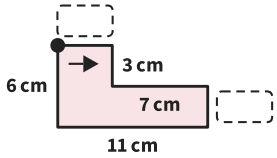

Perimeter = _____

3 Work out the perimeter.

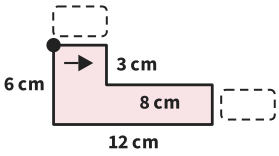

Perimeter = _____

The Maths Habit

Perimeter of compound shapes

Exit ticket Name _____

1 Work out the perimeter.

1 Missing ↔ 10 − 6 = ☐
↕ 6 − 3 = ☐

2 Add ☐ + ☐ + ☐ + ☐ + ☐ + ☐

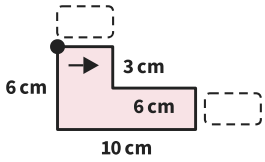

Perimeter = _____

2 Work out the perimeter.

1 Missing ↔ ☐ − ☐ = ☐
↕ ☐ − ☐ = ☐

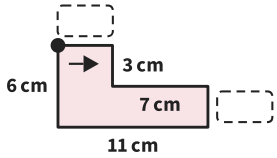

Perimeter = _____

3 Work out the perimeter.

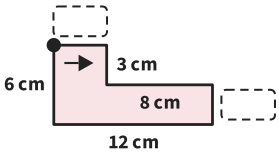

Perimeter = _____

The Maths Habit

Perimeter of compound shapes

Exit ticket Name _____

1 Work out the perimeter.

1 Missing ↔ 10 − 6 = ☐
↕ 6 − 3 = ☐

2 Add ☐ + ☐ + ☐ + ☐ + ☐ + ☐

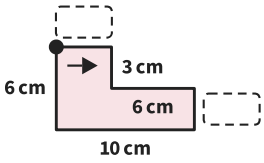

Perimeter = _____

2 Work out the perimeter.

1 Missing ↔ ☐ − ☐ = ☐
↕ ☐ − ☐ = ☐

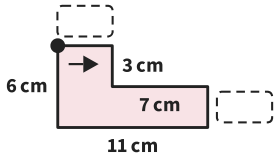

Perimeter = _____

3 Work out the perimeter.

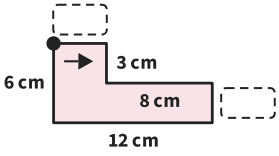

Perimeter = _____

The Maths Habit

Perimeter of compound shapes

Exit ticket Name _____

1 Work out the perimeter.

1 Missing ↔ 10 − 6 = ☐
↕ 6 − 3 = ☐

2 Add ☐ + ☐ + ☐ + ☐ + ☐ + ☐

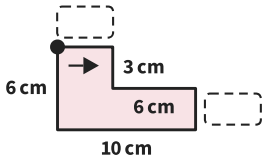

Perimeter = _____

2 Work out the perimeter.

1 Missing ↔ ☐ − ☐ = ☐
↕ ☐ − ☐ = ☐

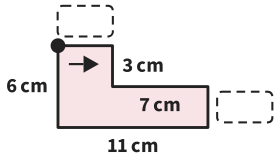

Perimeter = _____

3 Work out the perimeter.

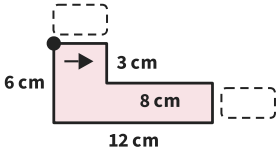

Perimeter = _____

The Maths Habit