Inequalities and regions: one inequality

Exit ticket Name _____

1. Is the line for $x \geq 3$ dashed or solid? Which side of the line is the region?

2. Is the point (3, 1) in the region $y \geq x - 2$? Show how you know.

3. Show $y < x - 2$ on the grid.

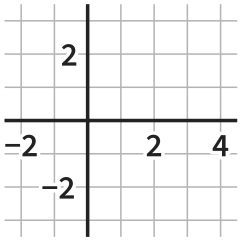

The Maths Habit

Inequalities and regions: one inequality

Exit ticket Name _____

1. Is the line for $x \geq 3$ dashed or solid? Which side of the line is the region?

2. Is the point (3, 1) in the region $y \geq x - 2$? Show how you know.

3. Show $y < x - 2$ on the grid.

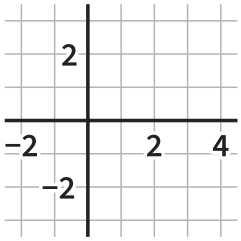

The Maths Habit

Inequalities and regions: one inequality

Exit ticket Name _____

1. Is the line for $x \geq 3$ dashed or solid? Which side of the line is the region?

2. Is the point (3, 1) in the region $y \geq x - 2$? Show how you know.

3. Show $y < x - 2$ on the grid.

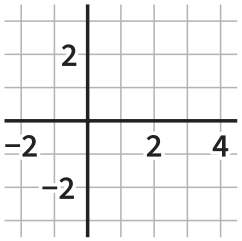

The Maths Habit

Inequalities and regions: one inequality

Exit ticket Name _____

1. Is the line for $x \geq 3$ dashed or solid? Which side of the line is the region?

2. Is the point (3, 1) in the region $y \geq x - 2$? Show how you know.

3. Show $y < x - 2$ on the grid.

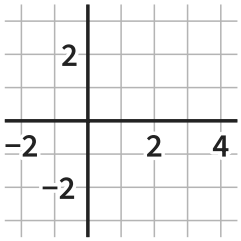

The Maths Habit

Inequalities and regions: one inequality

Exit ticket Name _____

1. Is the line for $x \geq 3$ dashed or solid? Which side of the line is the region?

2. Is the point (3, 1) in the region $y \geq x - 2$? Show how you know.

3. Show $y < x - 2$ on the grid.

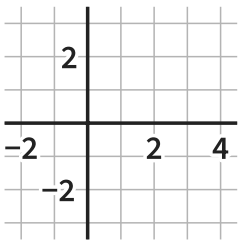

The Maths Habit

Inequalities and regions: one inequality

Exit ticket Name _____

1. Is the line for $x \geq 3$ dashed or solid? Which side of the line is the region?

2. Is the point (3, 1) in the region $y \geq x - 2$? Show how you know.

3. Show $y < x - 2$ on the grid.

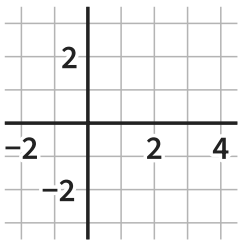

The Maths Habit