Inequalities and regions: describing a region

Exit ticket Name _____

1. R is above the solid line $y = 2x - 1$ and below the dashed line $y = 3$. Write two inequalities for R.

2. List the points with integer coordinates in the region where $y > 0$, $x \geq -1$ and $x + y \leq 2$.

3. Write down the three inequalities that describe R.

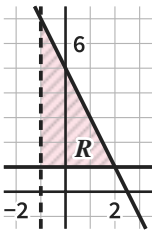

The Maths Habit

Inequalities and regions: describing a region

Exit ticket Name _____

1. R is above the solid line $y = 2x - 1$ and below the dashed line $y = 3$. Write two inequalities for R.

2. List the points with integer coordinates in the region where $y > 0$, $x \geq -1$ and $x + y \leq 2$.

3. Write down the three inequalities that describe R.

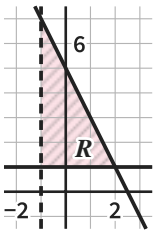

The Maths Habit

Inequalities and regions: describing a region

Exit ticket Name _____

1. R is above the solid line $y = 2x - 1$ and below the dashed line $y = 3$. Write two inequalities for R.

2. List the points with integer coordinates in the region where $y > 0$, $x \geq -1$ and $x + y \leq 2$.

3. Write down the three inequalities that describe R.

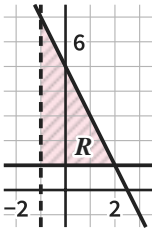

The Maths Habit

Inequalities and regions: describing a region

Exit ticket Name _____

1. R is above the solid line $y = 2x - 1$ and below the dashed line $y = 3$. Write two inequalities for R.

2. List the points with integer coordinates in the region where $y > 0$, $x \geq -1$ and $x + y \leq 2$.

3. Write down the three inequalities that describe R.

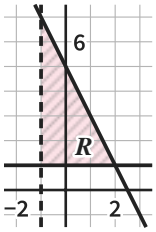

The Maths Habit

Inequalities and regions: describing a region

Exit ticket Name _____

1. R is above the solid line $y = 2x - 1$ and below the dashed line $y = 3$. Write two inequalities for R.

2. List the points with integer coordinates in the region where $y > 0$, $x \geq -1$ and $x + y \leq 2$.

3. Write down the three inequalities that describe R.

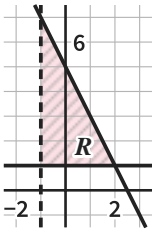

The Maths Habit

Inequalities and regions: describing a region

Exit ticket Name _____

1. R is above the solid line $y = 2x - 1$ and below the dashed line $y = 3$. Write two inequalities for R.

2. List the points with integer coordinates in the region where $y > 0$, $x \geq -1$ and $x + y \leq 2$.

3. Write down the three inequalities that describe R.

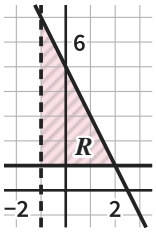

The Maths Habit