Inequalities and regions: the boundary line

Exit ticket Name _____

1. Is the boundary line of $x > -2$ dashed or solid? Is it vertical or horizontal?

2. Complete the table of values for $y = 3 - 2x$ when $x = -1$, 0, 1 and 2.

3. Draw the boundary line of $y \geq x - 1$ on the grid.

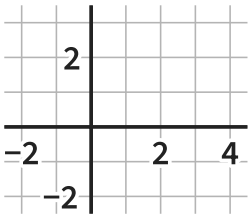

The Maths Habit

Inequalities and regions: the boundary line

Exit ticket Name _____

1. Is the boundary line of $x > -2$ dashed or solid? Is it vertical or horizontal?

2. Complete the table of values for $y = 3 - 2x$ when $x = -1$, 0, 1 and 2.

3. Draw the boundary line of $y \geq x - 1$ on the grid.

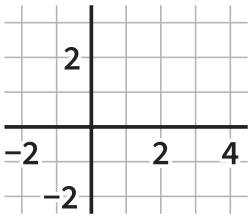

The Maths Habit

Inequalities and regions: the boundary line

Exit ticket Name _____

1. Is the boundary line of $x > -2$ dashed or solid? Is it vertical or horizontal?

2. Complete the table of values for $y = 3 - 2x$ when $x = -1$, 0, 1 and 2.

3. Draw the boundary line of $y \geq x - 1$ on the grid.

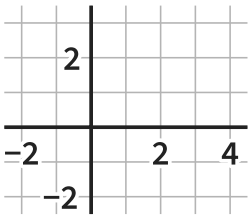

The Maths Habit

Inequalities and regions: the boundary line

Exit ticket Name _____

1. Is the boundary line of $x > -2$ dashed or solid? Is it vertical or horizontal?

2. Complete the table of values for $y = 3 - 2x$ when $x = -1$, 0, 1 and 2.

3. Draw the boundary line of $y \geq x - 1$ on the grid.

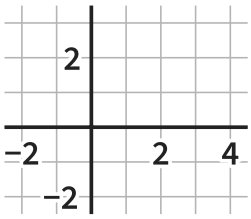

The Maths Habit

Inequalities and regions: the boundary line

Exit ticket Name _____

1. Is the boundary line of $x > -2$ dashed or solid? Is it vertical or horizontal?

2. Complete the table of values for $y = 3 - 2x$ when $x = -1$, 0, 1 and 2.

3. Draw the boundary line of $y \geq x - 1$ on the grid.

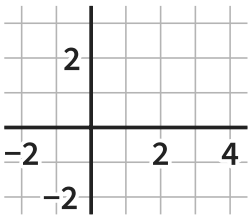

The Maths Habit

Inequalities and regions: the boundary line

Exit ticket Name _____

1. Is the boundary line of $x > -2$ dashed or solid? Is it vertical or horizontal?

2. Complete the table of values for $y = 3 - 2x$ when $x = -1$, 0, 1 and 2.

3. Draw the boundary line of $y \geq x - 1$ on the grid.

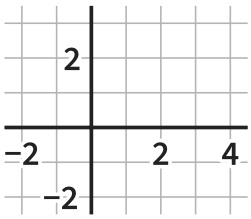

The Maths Habit