Equation of a circle

Exit ticket Name _____

1 The circle has centre (0, 0).
Write its equation.

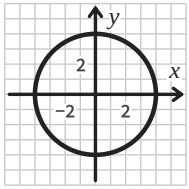

_____

2 Write down the radius of the circle $x^2 + y^2 = 81$.

_____

3 Is the point (−2, 5) inside, on or outside the circle $x^2 + y^2 = 25$? Show how you know.

_____

Equation of a circle

Exit ticket Name _____

1 The circle has centre (0, 0).
Write its equation.

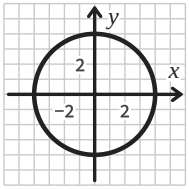

_____

2 Write down the radius of the circle $x^2 + y^2 = 81$.

_____

3 Is the point (−2, 5) inside, on or outside the circle $x^2 + y^2 = 25$? Show how you know.

_____

The Maths Habit

Equation of a circle

Exit ticket Name _____

1 The circle has centre (0, 0).
Write its equation.

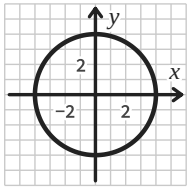

_____

2 Write down the radius of the circle $x^2 + y^2 = 81$.

_____

3 Is the point (−2, 5) inside, on or outside the circle $x^2 + y^2 = 25$? Show how you know.

_____

The Maths Habit

Equation of a circle

Exit ticket Name _____

1 The circle has centre (0, 0).
Write its equation.

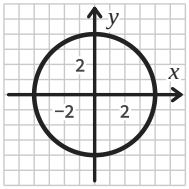

_____

2 Write down the radius of the circle $x^2 + y^2 = 81$.

_____

3 Is the point (−2, 5) inside, on or outside the circle $x^2 + y^2 = 25$? Show how you know.

_____

The Maths Habit

Equation of a circle

Exit ticket Name _____

1 The circle has centre (0, 0).
Write its equation.

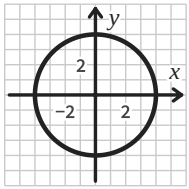

_____

2 Write down the radius of the circle $x^2 + y^2 = 81$.

_____

3 Is the point (−2, 5) inside, on or outside the circle $x^2 + y^2 = 25$? Show how you know.

_____

The Maths Habit

Equation of a circle

Exit ticket Name _____

1 The circle has centre (0, 0).
Write its equation.

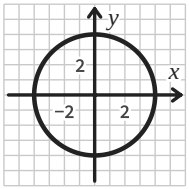

_____

2 Write down the radius of the circle $x^2 + y^2 = 81$.

_____

3 Is the point (−2, 5) inside, on or outside the circle $x^2 + y^2 = 25$? Show how you know.

_____

The Maths Habit