Cumulative frequency graphs

Exit ticket Name _____

1 Complete the cumulative frequency column of the table.

Time, t (s)	Frequency	Cumulative frequency
$0 < t \leq 10$	6	
$10 < t \leq 20$	11	
$20 < t \leq 30$	9	
$30 < t \leq 40$	4	

2 Which point is plotted for $10 < t \leq 20$?

_____

3 Draw the cumulative frequency graph for question 1 on the grid.

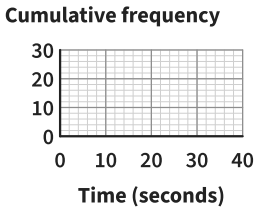

The Maths Habit

Cumulative frequency graphs

Exit ticket Name _____

1 Complete the cumulative frequency column of the table.

Time, t (s)	Frequency	Cumulative frequency
$0 < t \leq 10$	6	
$10 < t \leq 20$	11	
$20 < t \leq 30$	9	
$30 < t \leq 40$	4	

2 Which point is plotted for $10 < t \leq 20$?

_____

3 Draw the cumulative frequency graph for question 1 on the grid.

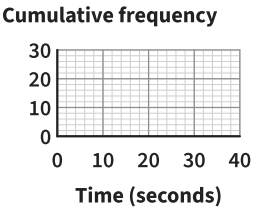

The Maths Habit

Cumulative frequency graphs

Exit ticket Name _____

1 Complete the cumulative frequency column of the table.

Time, t (s)	Frequency	Cumulative frequency
$0 < t \leq 10$	6	
$10 < t \leq 20$	11	
$20 < t \leq 30$	9	
$30 < t \leq 40$	4	

2 Which point is plotted for $10 < t \leq 20$?

_____

3 Draw the cumulative frequency graph for question 1 on the grid.

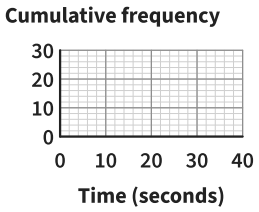

The Maths Habit

Cumulative frequency graphs

Exit ticket Name _____

1 Complete the cumulative frequency column of the table.

Time, t (s)	Frequency	Cumulative frequency
$0 < t \leq 10$	6	
$10 < t \leq 20$	11	
$20 < t \leq 30$	9	
$30 < t \leq 40$	4	

2 Which point is plotted for $10 < t \leq 20$?

_____

3 Draw the cumulative frequency graph for question 1 on the grid.

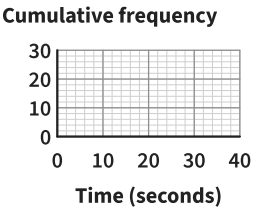

The Maths Habit

Cumulative frequency graphs

Exit ticket Name _____

1 Complete the cumulative frequency column of the table.

Time, t (s)	Frequency	Cumulative frequency
$0 < t \leq 10$	6	
$10 < t \leq 20$	11	
$20 < t \leq 30$	9	
$30 < t \leq 40$	4	

2 Which point is plotted for $10 < t \leq 20$?

_____

3 Draw the cumulative frequency graph for question 1 on the grid.

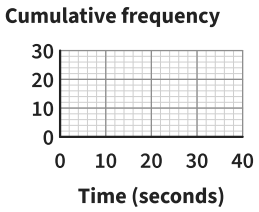

The Maths Habit

Cumulative frequency graphs

Exit ticket Name _____

1 Complete the cumulative frequency column of the table.

Time, t (s)	Frequency	Cumulative frequency
$0 < t \leq 10$	6	
$10 < t \leq 20$	11	
$20 < t \leq 30$	9	
$30 < t \leq 40$	4	

2 Which point is plotted for $10 < t \leq 20$?

_____

3 Draw the cumulative frequency graph for question 1 on the grid.

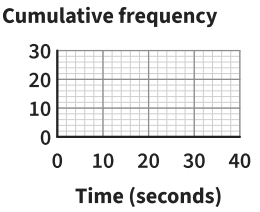

The Maths Habit