The cosine rule

Exit ticket Name _____

1 Find angle x.

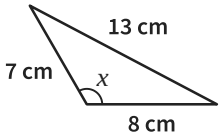

x = _____

2 Find angle x. Give your answer to 1 decimal place.

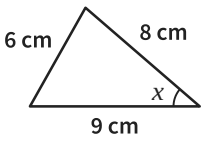

x = _____

3 A triangle has sides of 6 cm, 7 cm and 10 cm. Find its largest angle. Give your answer to 1 decimal place.

_____

The Maths Habit

The cosine rule

Exit ticket Name _____

1 Find angle x.

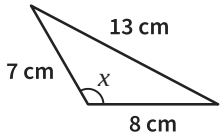

x = _____

2 Find angle x. Give your answer to 1 decimal place.

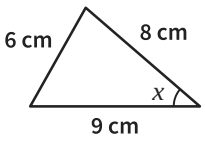

x = _____

3 A triangle has sides of 6 cm, 7 cm and 10 cm. Find its largest angle. Give your answer to 1 decimal place.

_____

The Maths Habit

The cosine rule

Exit ticket Name _____

1 Find angle x.

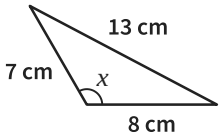

x = _____

2 Find angle x. Give your answer to 1 decimal place.

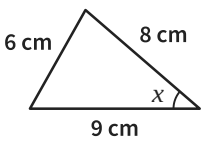

x = _____

3 A triangle has sides of 6 cm, 7 cm and 10 cm. Find its largest angle. Give your answer to 1 decimal place.

_____

The Maths Habit

The cosine rule

Exit ticket Name _____

1 Find angle x.

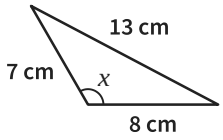

x = _____

2 Find angle x. Give your answer to 1 decimal place.

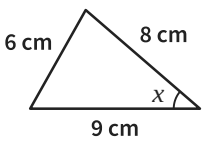

x = _____

3 A triangle has sides of 6 cm, 7 cm and 10 cm. Find its largest angle. Give your answer to 1 decimal place.

_____

The Maths Habit

The cosine rule

Exit ticket Name _____

1 Find angle x.

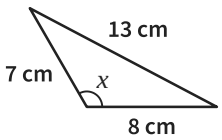

x = _____

2 Find angle x. Give your answer to 1 decimal place.

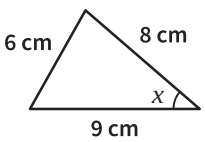

x = _____

3 A triangle has sides of 6 cm, 7 cm and 10 cm. Find its largest angle. Give your answer to 1 decimal place.

_____

The Maths Habit

The cosine rule

Exit ticket Name _____

1 Find angle x.

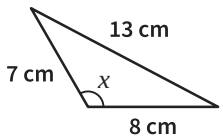

x = _____

2 Find angle x. Give your answer to 1 decimal place.

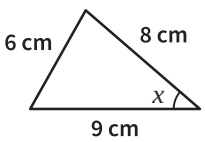

x = _____

3 A triangle has sides of 6 cm, 7 cm and 10 cm. Find its largest angle. Give your answer to 1 decimal place.

_____

The Maths Habit