Conditional probability: tree diagrams

Exit ticket Name _____

1 A bag has 2 red and 7 green counters. Two are taken without replacement. Fill in the tree diagram.

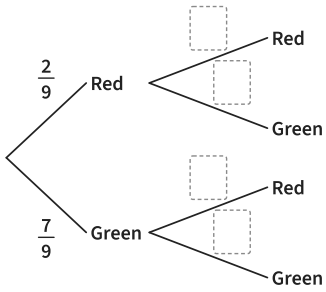

2 Find the probability of one counter of each colour.

3 Find the probability that at least one is red.

Conditional probability: tree diagrams

Exit ticket Name _____

1 A bag has 2 red and 7 green counters. Two are taken without replacement. Fill in the tree diagram.

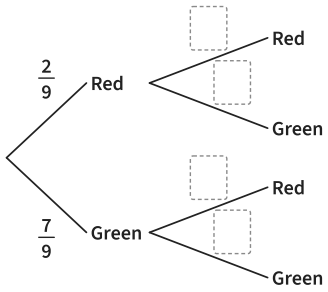

2 Find the probability of one counter of each colour.

3 Find the probability that at least one is red.

The Maths Habit

Conditional probability: tree diagrams

Exit ticket Name _____

1 A bag has 2 red and 7 green counters. Two are taken without replacement. Fill in the tree diagram.

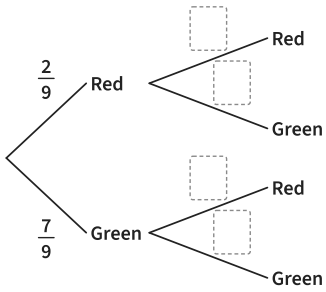

2 Find the probability of one counter of each colour.

3 Find the probability that at least one is red.

The Maths Habit

Conditional probability: tree diagrams

Exit ticket Name _____

1 A bag has 2 red and 7 green counters. Two are taken without replacement. Fill in the tree diagram.

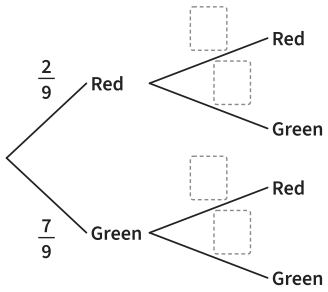

2 Find the probability of one counter of each colour.

3 Find the probability that at least one is red.

The Maths Habit

Conditional probability: tree diagrams

Exit ticket Name _____

1 A bag has 2 red and 7 green counters. Two are taken without replacement. Fill in the tree diagram.

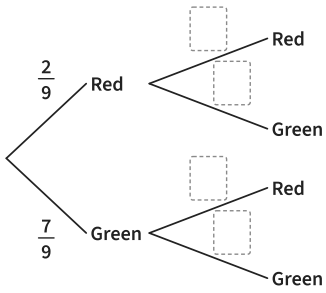

2 Find the probability of one counter of each colour.

3 Find the probability that at least one is red.

The Maths Habit

Conditional probability: tree diagrams

Exit ticket Name _____

1 A bag has 2 red and 7 green counters. Two are taken without replacement. Fill in the tree diagram.

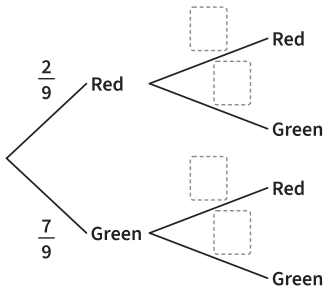

2 Find the probability of one counter of each colour.

3 Find the probability that at least one is red.

The Maths Habit