Circle theorems: tangents

Exit ticket Name _____

1 PT is a tangent at T and O is the centre. Angle TOP = 37°. Find angle OPT. Give a reason.

_____

2 PT is a tangent to the circle, centre O. Find OP.

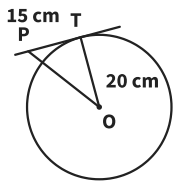

OP = _____

3 PT is a tangent to the circle, centre O. Find PT.

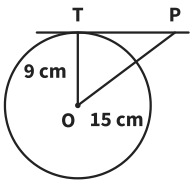

PT = _____

Circle theorems: tangents

Exit ticket Name _____

1 PT is a tangent at T and O is the centre. Angle TOP = 37°. Find angle OPT. Give a reason.

_____

2 PT is a tangent to the circle, centre O. Find OP.

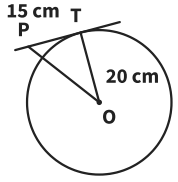

OP = _____

3 PT is a tangent to the circle, centre O. Find PT.

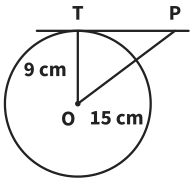

PT = _____

The Maths Habit

Circle theorems: tangents

Exit ticket Name _____

1 PT is a tangent at T and O is the centre. Angle TOP = 37°. Find angle OPT. Give a reason.

_____

2 PT is a tangent to the circle, centre O. Find OP.

OP = _____

3 PT is a tangent to the circle, centre O. Find PT.

PT = _____

The Maths Habit

Circle theorems: tangents

Exit ticket Name _____

1 PT is a tangent at T and O is the centre. Angle TOP = 37°. Find angle OPT. Give a reason.

_____

2 PT is a tangent to the circle, centre O. Find OP.

OP = _____

3 PT is a tangent to the circle, centre O. Find PT.

PT = _____

The Maths Habit

Circle theorems: tangents

Exit ticket Name _____

1 PT is a tangent at T and O is the centre. Angle TOP = 37°. Find angle OPT. Give a reason.

_____

2 PT is a tangent to the circle, centre O. Find OP.

OP = _____

3 PT is a tangent to the circle, centre O. Find PT.

PT = _____

The Maths Habit

Circle theorems: tangents

Exit ticket Name _____

1 PT is a tangent at T and O is the centre. Angle TOP = 37°. Find angle OPT. Give a reason.

_____

2 PT is a tangent to the circle, centre O. Find OP.

OP = _____

3 PT is a tangent to the circle, centre O. Find PT.

PT = _____

The Maths Habit