Circle theorems: angles in the same segment

Exit ticket Name _____

1 C and D are on a circle, on the same side of the chord AB. Angle ACB = 51°. Find angle ADB.

Angle ADB = _____

2 Find x and y.

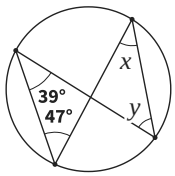

_____

3 Find x. Give a reason.

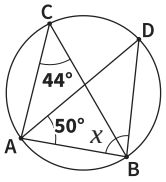

_____

Circle theorems: angles in the same segment

Exit ticket Name _____

1 C and D are on a circle, on the same side of the chord AB. Angle ACB = 51°. Find angle ADB.

Angle ADB = _____

2 Find x and y.

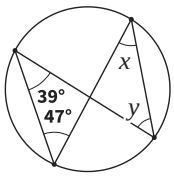

_____

3 Find x. Give a reason.

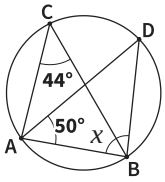

_____

The Maths Habit

Circle theorems: angles in the same segment

Exit ticket Name _____

1 C and D are on a circle, on the same side of the chord AB. Angle ACB = 51°. Find angle ADB.

Angle ADB = _____

2 Find x and y.

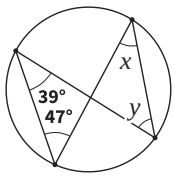

_____

3 Find x. Give a reason.

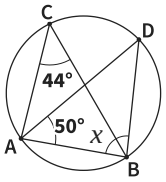

_____

The Maths Habit

Circle theorems: angles in the same segment

Exit ticket Name _____

1 C and D are on a circle, on the same side of the chord AB. Angle ACB = 51°. Find angle ADB.

Angle ADB = _____

2 Find x and y.

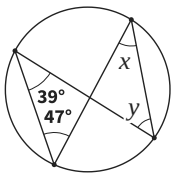

_____

3 Find x. Give a reason.

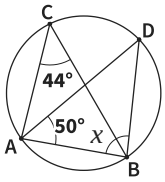

_____

The Maths Habit

Circle theorems: angles in the same segment

Exit ticket Name _____

1 C and D are on a circle, on the same side of the chord AB. Angle ACB = 51°. Find angle ADB.

Angle ADB = _____

2 Find x and y.

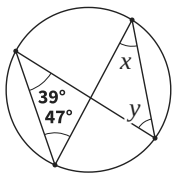

_____

3 Find x. Give a reason.

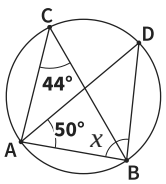

_____

The Maths Habit

Circle theorems: angles in the same segment

Exit ticket Name _____

1 C and D are on a circle, on the same side of the chord AB. Angle ACB = 51°. Find angle ADB.

Angle ADB = _____

2 Find x and y.

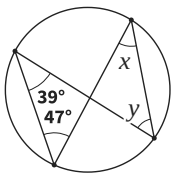

_____

3 Find x. Give a reason.

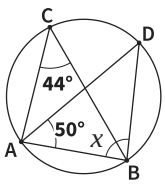

_____

The Maths Habit