Circle theorems: angle in a semicircle

Exit ticket Name _____

1 AB is a diameter. Find x.

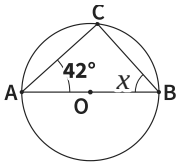

x = _____

2 AB is a diameter. Find x.

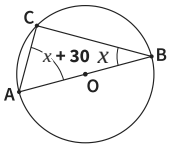

x = _____

3 AB is a diameter. Find x.
Give a reason.

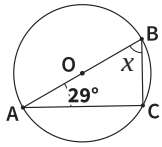

_____

Circle theorems: angle in a semicircle

Exit ticket Name _____

1 AB is a diameter. Find x.

x = _____

2 AB is a diameter. Find x.

x = _____

3 AB is a diameter. Find x.
Give a reason.

_____

The Maths Habit

Circle theorems: angle in a semicircle

Exit ticket Name _____

1 AB is a diameter. Find x.

x = _____

2 AB is a diameter. Find x.

x = _____

3 AB is a diameter. Find x.
Give a reason.

_____

The Maths Habit

Circle theorems: angle in a semicircle

Exit ticket Name _____

1 AB is a diameter. Find x.

x = _____

2 AB is a diameter. Find x.

x = _____

3 AB is a diameter. Find x.
Give a reason.

_____

The Maths Habit

Circle theorems: angle in a semicircle

Exit ticket Name _____

1 AB is a diameter. Find x.

x = _____

2 AB is a diameter. Find x.

x = _____

3 AB is a diameter. Find x.
Give a reason.

_____

The Maths Habit

Circle theorems: angle in a semicircle

Exit ticket Name _____

1 AB is a diameter. Find x.

x = _____

2 AB is a diameter. Find x.

x = _____

3 AB is a diameter. Find x.
Give a reason.

_____

The Maths Habit