Circle theorems: angle at the centre

Exit ticket Name _____

1 O is the centre. Find x.

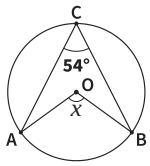

x = _____

2 O is the centre. Find x.

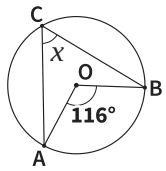

x = _____

3 O is the centre. Find x.
Give a reason.

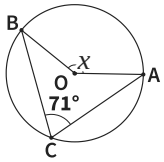

_____

Circle theorems: angle at the centre

Exit ticket Name _____

1 O is the centre. Find x.

x = _____

2 O is the centre. Find x.

x = _____

3 O is the centre. Find x.
Give a reason.

_____

The Maths Habit

Circle theorems: angle at the centre

Exit ticket Name _____

1 O is the centre. Find x.

x = _____

2 O is the centre. Find x.

x = _____

3 O is the centre. Find x.
Give a reason.

_____

The Maths Habit

Circle theorems: angle at the centre

Exit ticket Name _____

1 O is the centre. Find x.

x = _____

2 O is the centre. Find x.

x = _____

3 O is the centre. Find x.
Give a reason.

_____

The Maths Habit

Circle theorems: angle at the centre

Exit ticket Name _____

1 O is the centre. Find x.

x = _____

2 O is the centre. Find x.

x = _____

3 O is the centre. Find x.
Give a reason.

_____

The Maths Habit