Box plots

Exit ticket Name _____

1. The box plot shows the ages of some people at a café. Write down the median age.

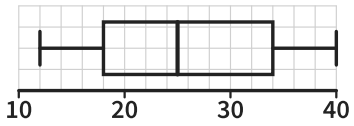

_____

2. Find the interquartile range of the ages in question 1.

_____

3. Lowest 4, lower quartile 9, median 12, upper quartile 18, highest 22.
Draw a box plot.

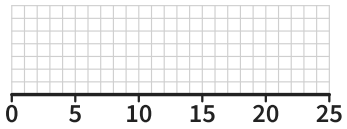

Box plots

Exit ticket Name _____

1. The box plot shows the ages of some people at a café. Write down the median age.

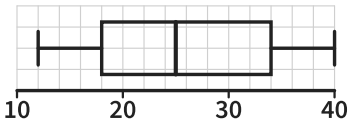

_____

2. Find the interquartile range of the ages in question 1.

_____

3. Lowest 4, lower quartile 9, median 12, upper quartile 18, highest 22.
Draw a box plot.

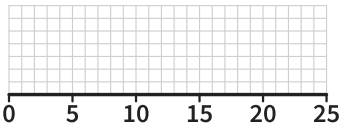

The Maths Habit

Box plots

Exit ticket Name _____

1. The box plot shows the ages of some people at a café. Write down the median age.

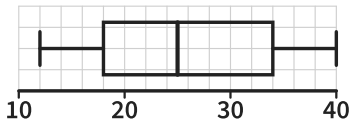

_____

2. Find the interquartile range of the ages in question 1.

_____

3. Lowest 4, lower quartile 9, median 12, upper quartile 18, highest 22.
Draw a box plot.

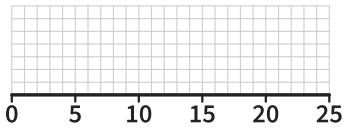

The Maths Habit

Box plots

Exit ticket Name _____

1. The box plot shows the ages of some people at a café. Write down the median age.

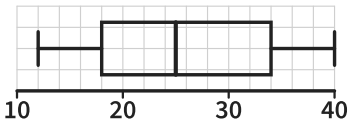

_____

2. Find the interquartile range of the ages in question 1.

_____

3. Lowest 4, lower quartile 9, median 12, upper quartile 18, highest 22.
Draw a box plot.

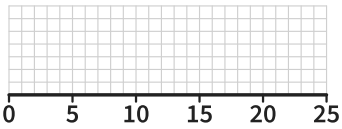

The Maths Habit

Box plots

Exit ticket Name _____

1. The box plot shows the ages of some people at a café. Write down the median age.

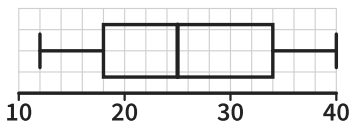

_____

2. Find the interquartile range of the ages in question 1.

_____

3. Lowest 4, lower quartile 9, median 12, upper quartile 18, highest 22.
Draw a box plot.

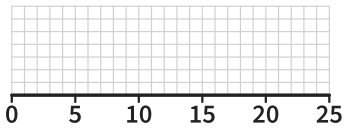

The Maths Habit

Box plots

Exit ticket Name _____

1. The box plot shows the ages of some people at a café. Write down the median age.

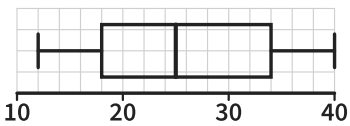

_____

2. Find the interquartile range of the ages in question 1.

_____

3. Lowest 4, lower quartile 9, median 12, upper quartile 18, highest 22.
Draw a box plot.

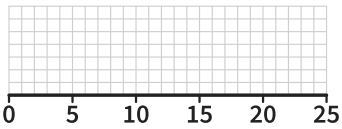

The Maths Habit