Area of a triangle: ½ab sin C

Exit ticket Name _____

1 Find the area of the triangle.

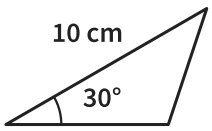

_____

2 Find the area of the triangle.
Give your answer to
1 decimal place.

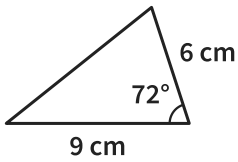

_____

3 Find the area of the triangle.
Give your answer to
1 decimal place.

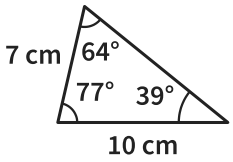

_____

The Maths Habit

Area of a triangle: ½ab sin C

Exit ticket Name _____

1 Find the area of the triangle.

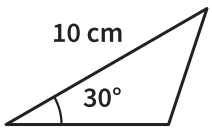

_____

2 Find the area of the triangle.
Give your answer to
1 decimal place.

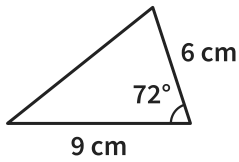

_____

3 Find the area of the triangle.
Give your answer to
1 decimal place.

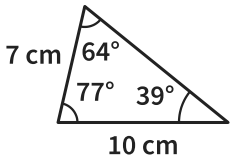

_____

The Maths Habit

Area of a triangle: ½ab sin C

Exit ticket Name _____

1 Find the area of the triangle.

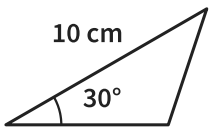

_____

2 Find the area of the triangle.
Give your answer to
1 decimal place.

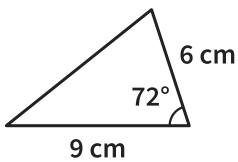

_____

3 Find the area of the triangle.
Give your answer to
1 decimal place.

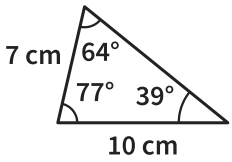

_____

The Maths Habit

Area of a triangle: ½ab sin C

Exit ticket Name _____

1 Find the area of the triangle.

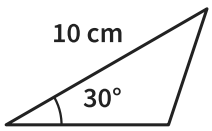

_____

2 Find the area of the triangle.
Give your answer to
1 decimal place.

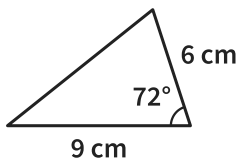

_____

3 Find the area of the triangle.
Give your answer to
1 decimal place.

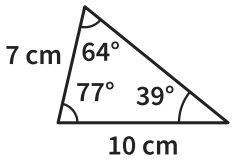

_____

The Maths Habit

Area of a triangle: ½ab sin C

Exit ticket Name _____

1 Find the area of the triangle.

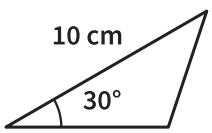

_____

2 Find the area of the triangle.
Give your answer to
1 decimal place.

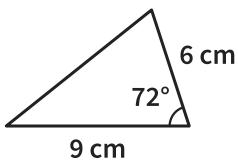

_____

3 Find the area of the triangle.
Give your answer to
1 decimal place.

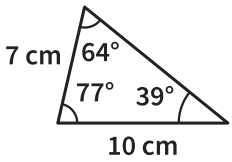

_____

The Maths Habit

Area of a triangle: ½ab sin C

Exit ticket Name _____

1 Find the area of the triangle.

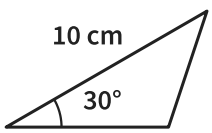

_____

2 Find the area of the triangle.
Give your answer to
1 decimal place.

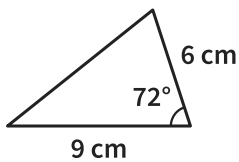

_____

3 Find the area of the triangle.
Give your answer to
1 decimal place.

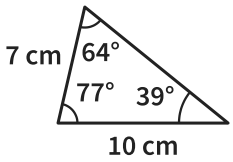

_____

The Maths Habit