Reading histograms *lesson handout*

We do

Find the frequency for $20 < m \leq 30$.

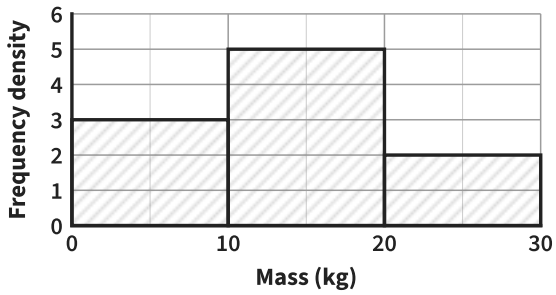

Class	Class width	Frequency density	Frequency
$20 < m \leq 30$	10		

You do

Find the frequency for $5 < h \leq 15$.

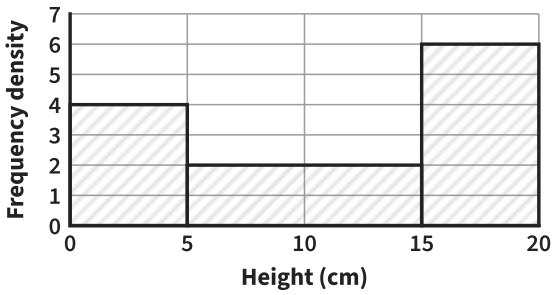

Class	Class width	Frequency density	Frequency
$5 < h \leq 15$			

You do

Find the frequency for $30 < t \leq 35$.

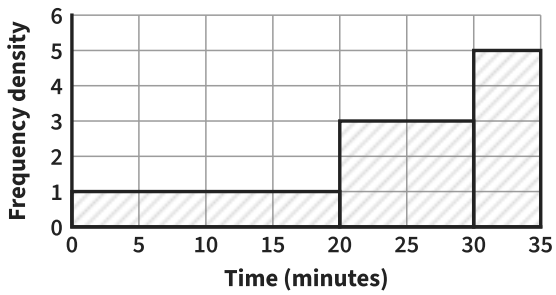

Class	Class width	Frequency density	Frequency
$30 < t \leq 35$			

We do

Estimate how many values are between 5 and 20.

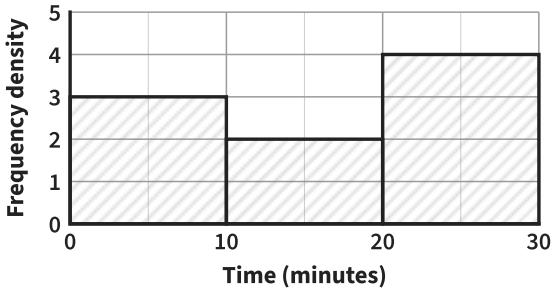

Class	Class width	Frequency density	Frequency
$5 < t \leq 10$	5	3	
$10 < t \leq 20$			

You do

Estimate how many values are between 10 and 25.

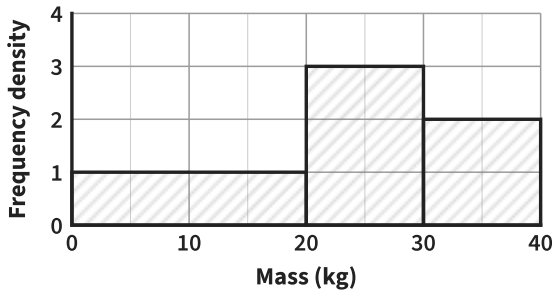

Class	Class width	Frequency density	Frequency
$10 < m \leq 20$			
$20 < m \leq 25$			

You do

Estimate how many values are less than 15.

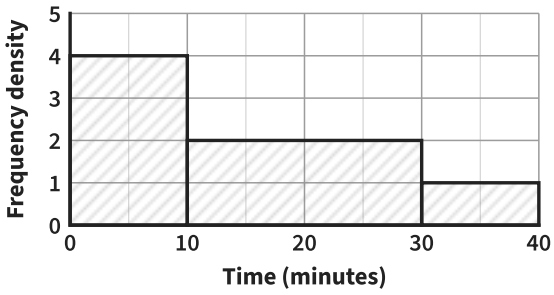

Class	Class width	Frequency density	Frequency
$0 < t \leq 10$			
$10 < t \leq 15$			