Inequalities and regions: one inequality *lesson handout*

Recap

Draw (b) $y = -2$ and (c) $y = 1 - 3x$.

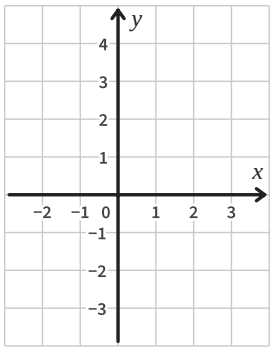

We do

Show $y > 2$ on the grid.

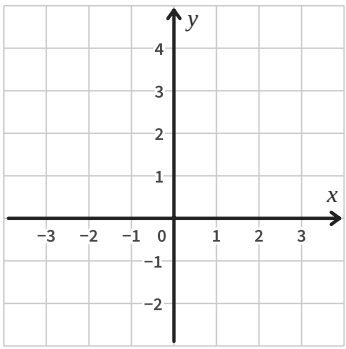

You do

Show $x < -2$ on the grid.

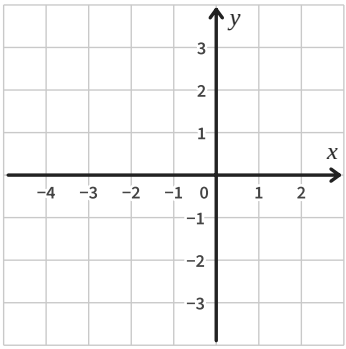

We do

Show $y \geq 2x - 3$ on the grid.

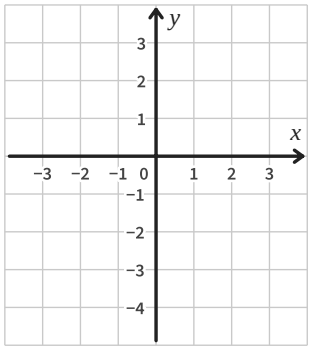

You do

Show $y > x + 2$ on the grid.

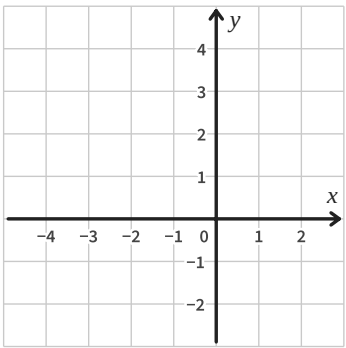

You do

Show $y \leq -x - 1$ on the grid.

