Inequalities and regions: the boundary line *lesson handout*

Turn and talk

Mark five points whose x coordinate is 3.

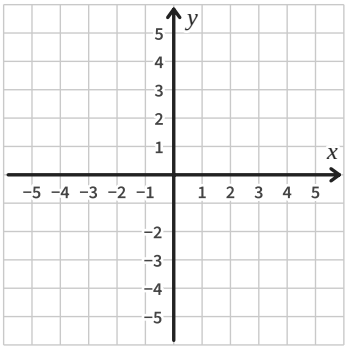

We do

Draw the boundary line of $y > -2$.

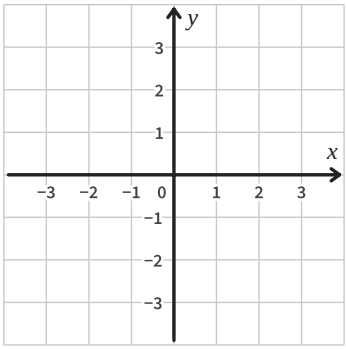

You do

Draw the boundary line of $x < -1$.

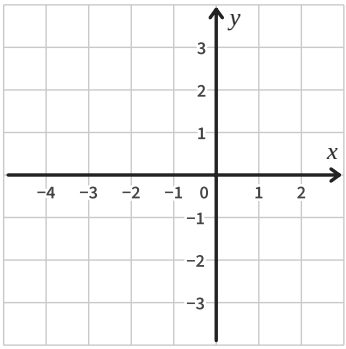

You do

Draw the boundary line of $y \geq 1$.

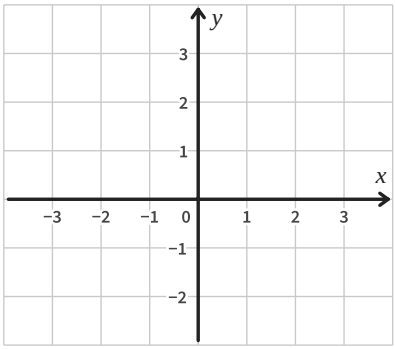

We do

Draw the boundary line of $y \geq x + 2$.

x	y
−1	
0	
1	
2	

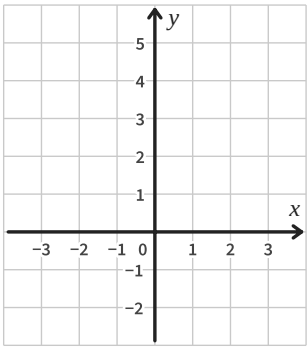

You do

Draw the boundary line of $y > 3 - x$.

x	y
−1	
0	
1	
2	

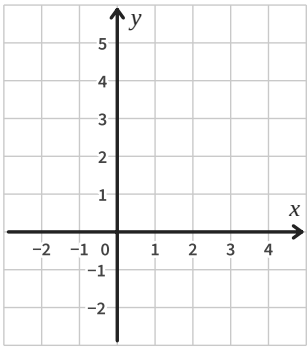

You do

Draw the boundary line of $y \leq 1 - 2x$.

x	y
−1	
0	
1	
2	

