Conditional probability: tree diagrams *lesson handout*

Turn and talk

A bag has 2 red counters and 1 blue counter. Two are taken out and not put back. List the orders.

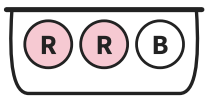

We do

A bag has 4 green and 5 yellow counters. Two are taken without replacement.

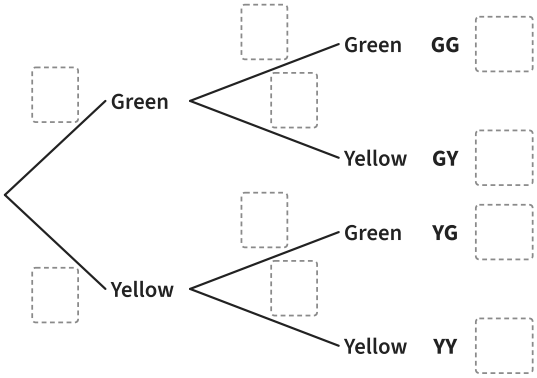

You do

A bag has 6 red and 4 blue counters. Two are taken without replacement.

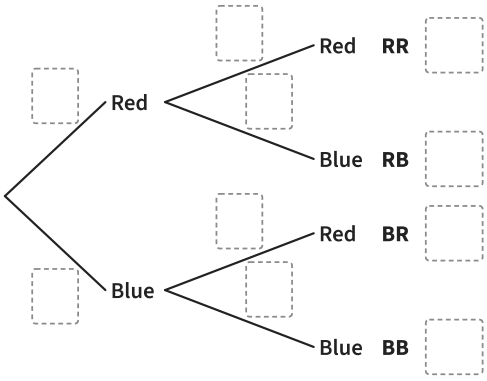

You do

A bag has 3 pink and 4 grey counters. Two are taken without replacement.

